Dividing with a Numberline

Name:

Use the numberline to solve each problem.

1) 4÷2=

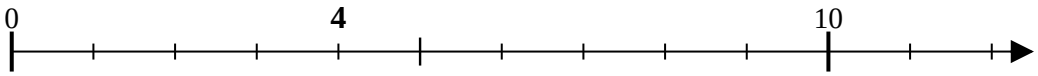

2) 16÷4=

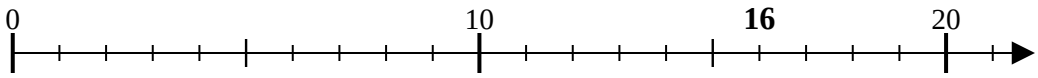

3) 10÷2=

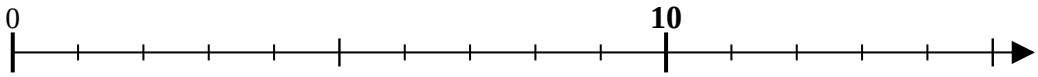

4) 24÷8=

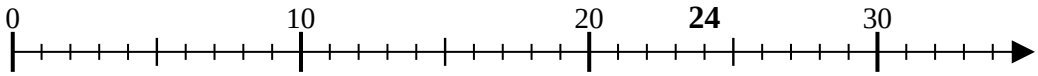

5) 28÷7=

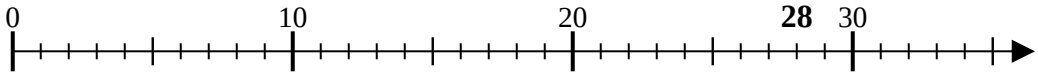

6) 9÷3=

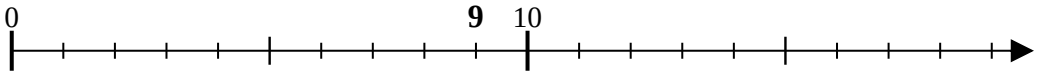

7) 32÷8=

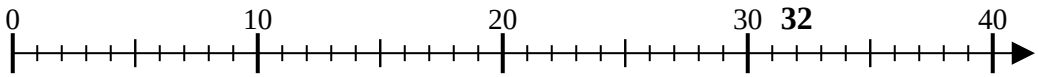

8) 6÷2=

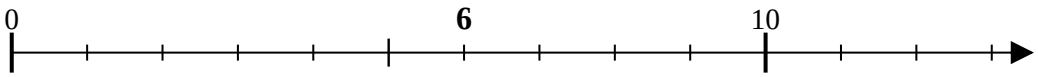

9) 45÷9=

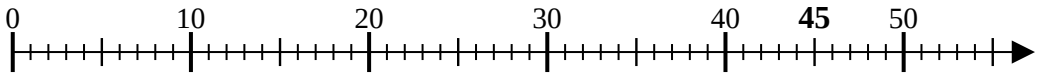

10) 10÷5=

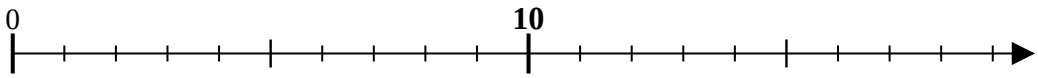

11) 30÷6=

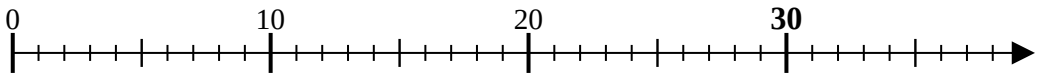

Answers

1. _____
2. _____
3. _____
4. _____
5. _____
6. _____
7. _____
8. _____
9. _____
10. _____
11. _____

1-10	91	82	73	64	55	45	36	27	18	9
11	0									

Dividing with a Numberline

Name: **Answer Key**

Use the numberline to solve each problem.

1) 4÷2=

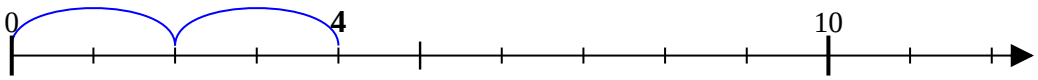

2) 16÷4=

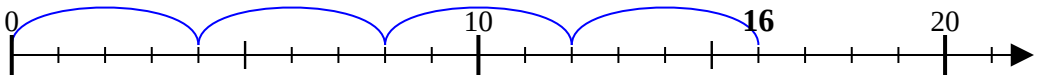

3) 10÷2=

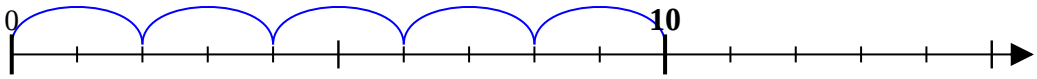

4) 24÷8=

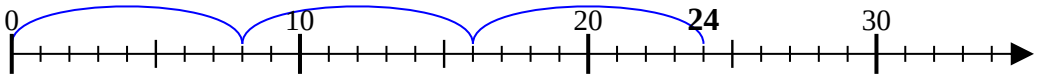

5) 28÷7=

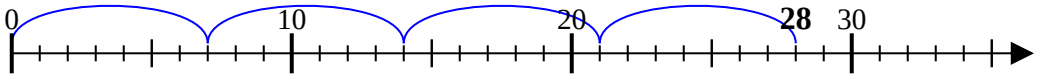

6) 9÷3=

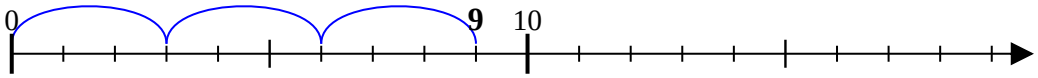

7) 32÷8=

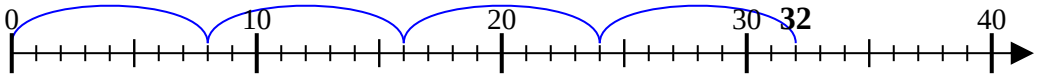

8) 6÷2=

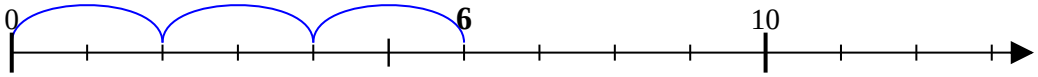

9) 45÷9=

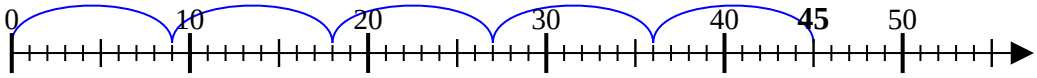

10) 10÷5=

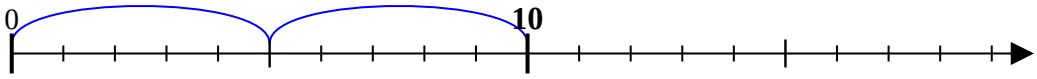

11) 30÷6=

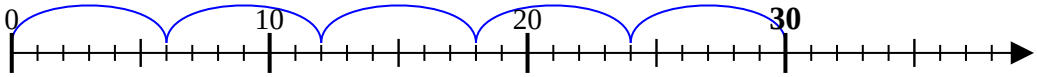

Answers

1. 2
2. 4
3. 5
4. 3
5. 4
6. 3
7. 4
8. 3
9. 5
10. 2
11. 5

1-10	91	82	73	64	55	45	36	27	18	9
11	0									